Finding Angles within Shapes

Name:

Count the number of Acute, Obtuse and Right and Reflex angles in each shape.

Ex)

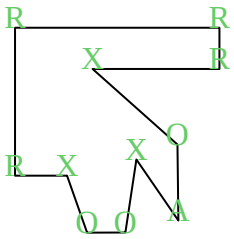

1)

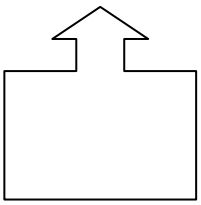

2)

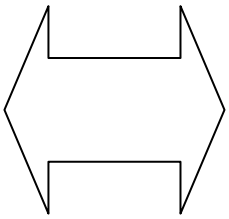

3)

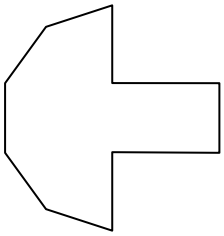

4)

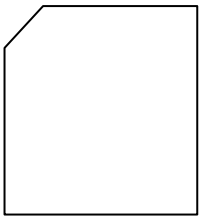

5)

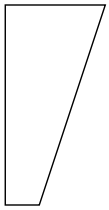

6)

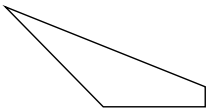

7)

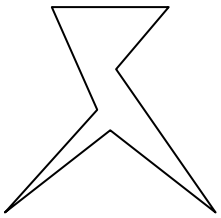

8)



9)

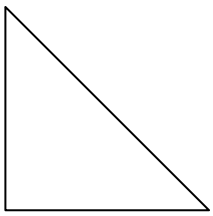

10)

11)

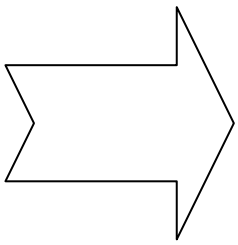

Answers

	A	O	R	X
Ex.	1	3	4	3
1.				
2.				
3.				
4.				
5.				
6.				
7.				
8.				
9.				
10.				
11.				

Finding Angles within Shapes

Name: **Answer Key**

Count the number of Acute, Obtuse and Right and Reflex angles in each shape.

Ex)

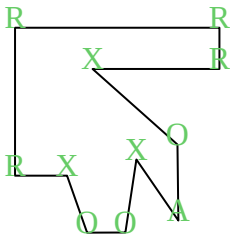

1)

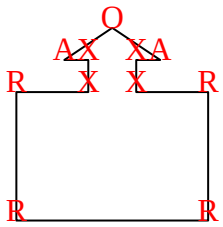

2)

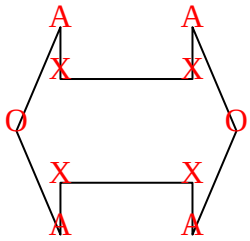

3)

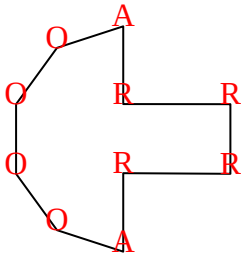

4)

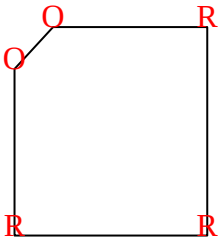

5)

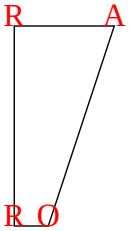

6)

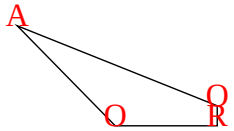

7)

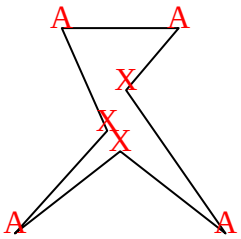

8)

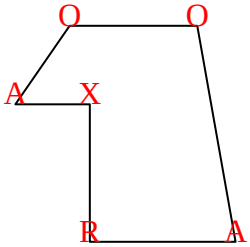

9)

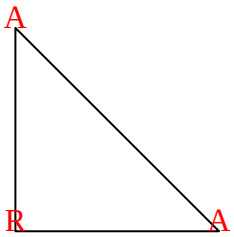

10)



11)

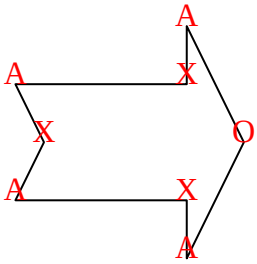

Answers

	A	O	R	X
Ex.	1	3	4	3
1.	2	1	4	4
2.	4	2	0	4
3.	2	4	4	0
4.	0	2	3	0
5.	1	1	2	0
6.	1	2	1	0
7.	4	0	0	3
8.	2	2	1	1
9.	2	0	1	0
10.	0	0	4	0
11.	4	1	0	3